MODULE 4
fiche 1 ★

1 Colorie le sac qui a autant de balles que celui de Mat.



2 Entoure la carte avec le plus de boutons.

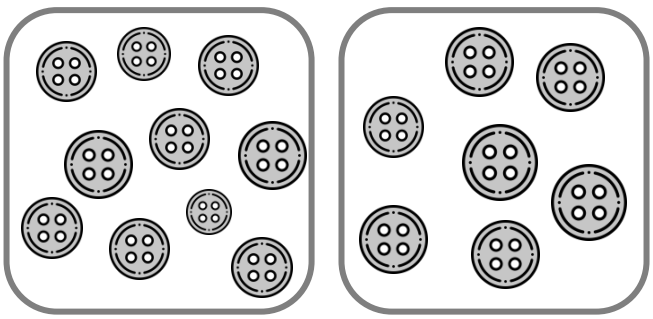

3 Entoure la carte avec le moins de trombones.

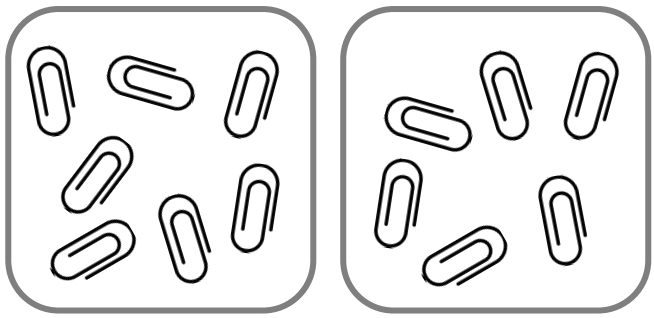

4 Complète ce que disent Mat et Tic.

J'ai _____ de jeton que Emma.



J'ai _____ de jeton que Emma.



5 Dessine autant de ○ que de ✕.

6 Dessine moins de ▲ que de ☾.



MONSTRES en classe

MODULE 4
fiche 1 ★

1 Colorie le sac qui a autant de balles que celui de Mat.

2 Entoure la carte avec le plus de boutons.

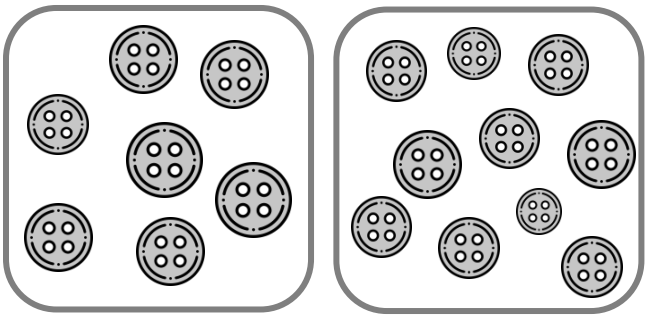

3 Entoure la carte avec le moins de trombones.

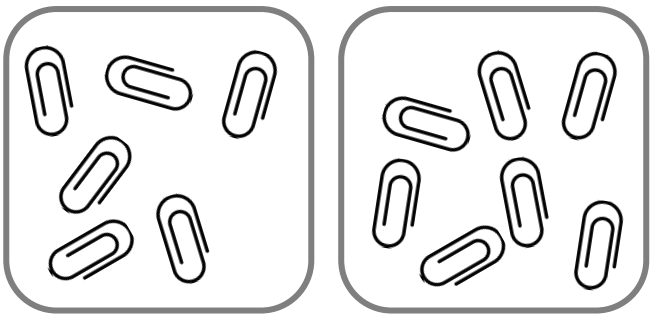

4 Complète ce que disent Mat et Tic.



5 Dessine autant de ○ que de ✕.

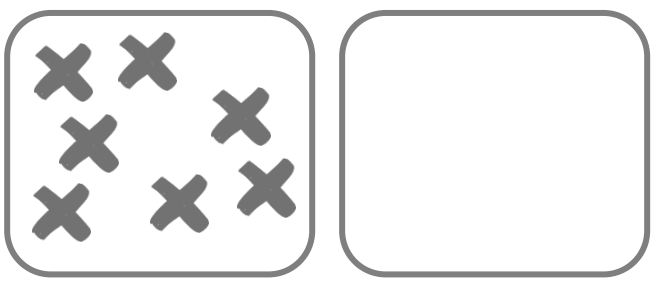

6 Dessine moins de ▲ que de ☾.



MONSTRES en classe

MODULE 4
fiche 1 ★★

1 Colorie le sac qui a autant de balles que celui de Mat.



2 Entoure la carte avec le plus de boutons.

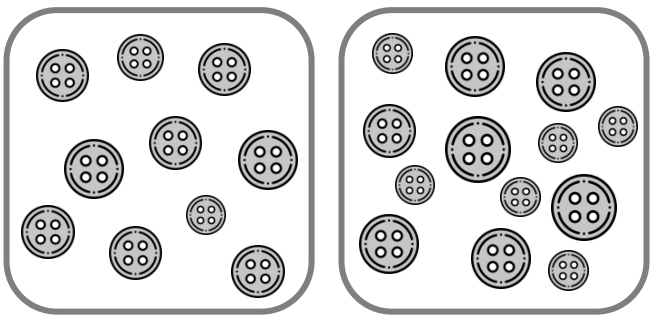

3 Entoure la carte avec le moins de trombones.

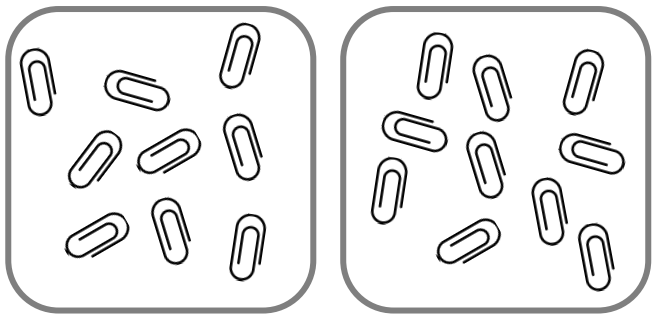

4 Complète ce que disent Mat et Tic.

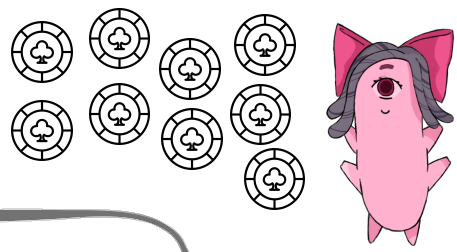

J'ai _____ de jeton que Emma.



J'ai _____ de jeton que Emma.



5 Dessine autant de ○ que de ✕.

6 Dessine moins de ▲ que de ☾.



MONSTRES en classe

MODULE 4
fiche 1 ★★

1 Colorie le sac qui a autant de balles que celui de Mat.

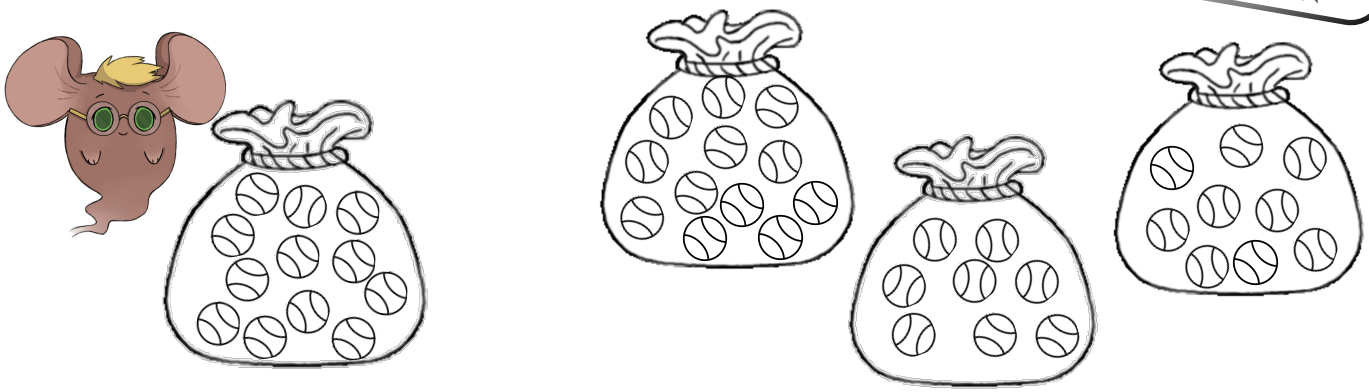

2 Entoure la carte avec le plus de boutons.

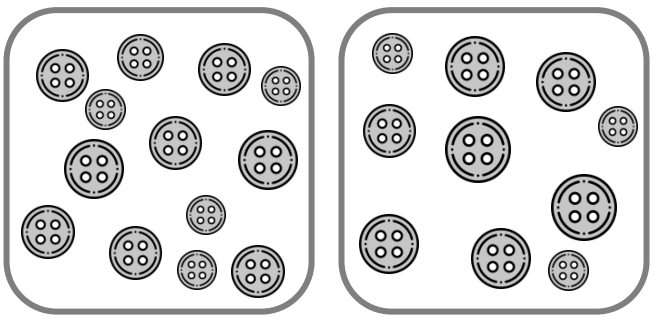

3 Entoure la carte avec le moins de trombones.

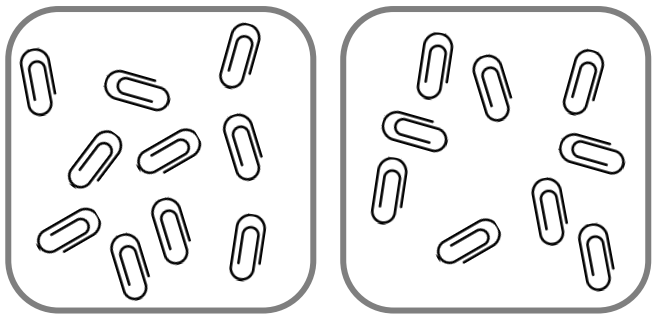

4 Complète ce que disent Mat et Tic.





5 Dessine autant de ○ que de ✕.

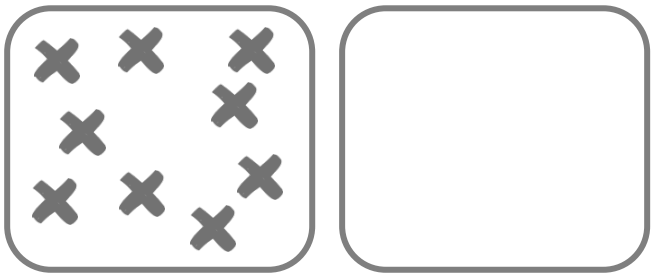

6 Dessine moins de ▲ que de ☾.

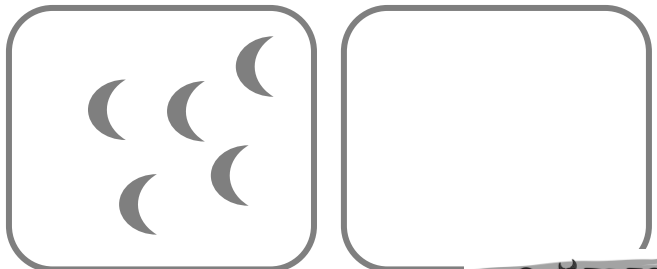

1 Complète en entourant le bon couvert.



il y a plus de

il y a moins de

2 Complète les phrases.

il y a ___ cubes
de _____ .

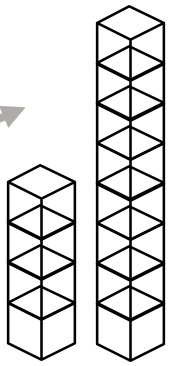

il y a ___ cubes
de _____ .

il y a ___ motos
de _____ .



il y a ___ casques
de _____ .

3 Complète les cartes en respectant les consignes.



2 ■ de plus que de ✖ .

3 | de plus que de ■ .

4 ● de moins que de ✖ .

autant de ♥ que de ● .

MONSTRES en classe

1 Complète en entourant le bon couvert.



il y a plus de

il y a moins de

2 Complète les phrases.

il y a ___ cubes
de _____ .

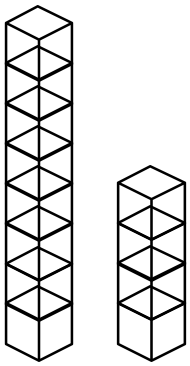

il y a ___ cubes
de _____ .

il y a ___ motos
de _____ .

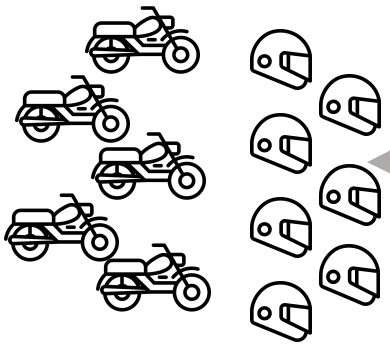

il y a ___ casques
de _____ .

3 Complète les cartes en respectant les consignes.



2 ■ de plus que de ✖ .

3 | de plus que de ■ .

4 ● de moins que de ✖ .

autant de ♥ que de ● .

MONSTRES en classe

MODULE 4
fiche 2 ★★

1 Complète en entourant le bon couvert.



il y a plus de

il y a moins de

2 Complète les phrases.

il y a ___ cubes
de _____ .

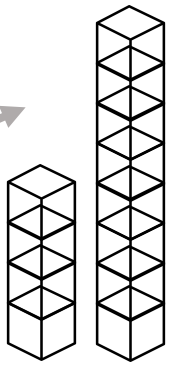

il y a ___ cubes
de _____ .

il y a ___ part
de _____ .



il y a ___ part
de _____ .

3 Construis des collections en respectant les consignes.

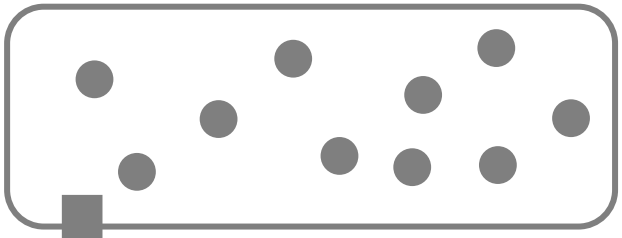

Il en faut 4 de moins.



Il en faut 6 de plus.

MONSTRES en classe

MODULE 4
fiche 2 ★★

1 Complète en entourant le bon couvert.



il y a plus de

il y a moins de

2 Complète les phrases.

il y a ___ cubes
de _____ .

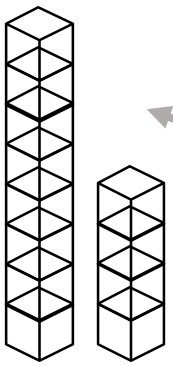

il y a ___ cubes
de _____ .

il y a ___ parts
de _____ .



il y a ___ parts
de _____ .

3 Construis des collections en respectant la consigne.



Il en faut 3 de moins.



Il en faut 5 de plus.

MONSTRES en classe

MODULE 4
fiche 3 ★

1 Colorie à chaque fois le plus grand nombre.

4 7

9 12

8 5

15 3 11

5 10 13

16 1 14

2 Range les nombres dans l'ordre croissant.

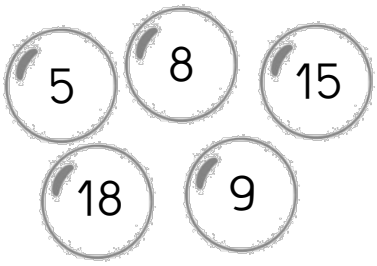

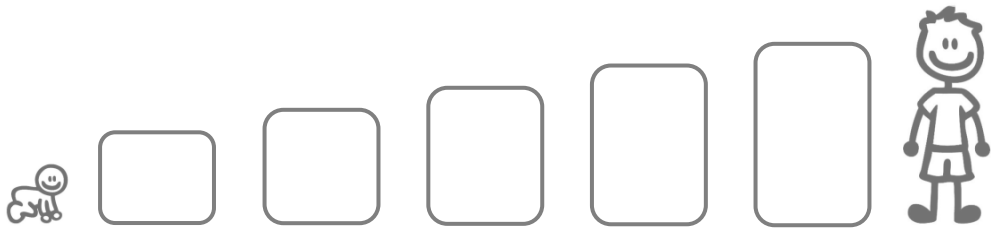

3 Range les nombres dans l'ordre décroissant.

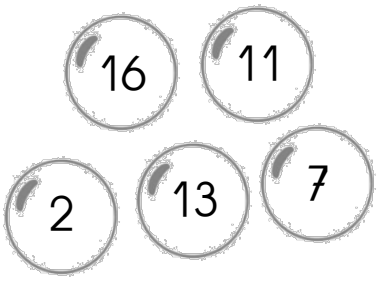

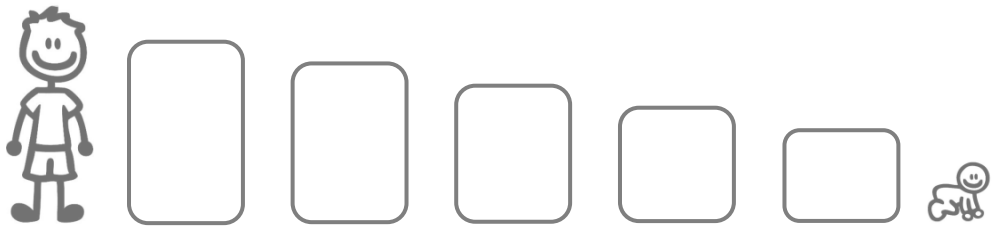

4 Ajuste les collections pour avoir le nombre demandé.



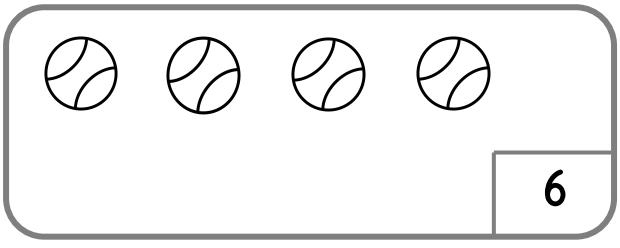

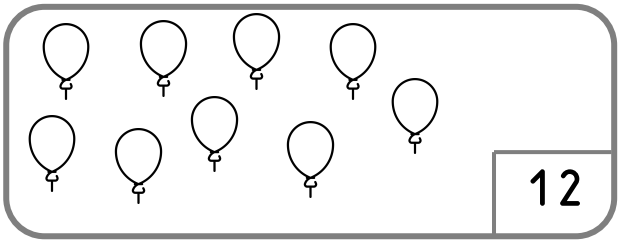



MONSTRES en classe

MODULE 4
fiche 3 ★★

1 Range les nombres dans l'ordre croissant.

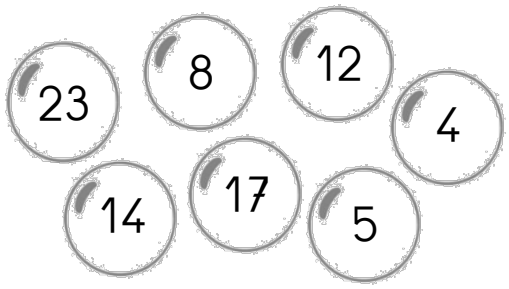

2 Colorie le plus grand nombre en bleu, le plus petit en jaune.

7	15
19	21

2	13
16	6

1	5
11	10

18	9
7	17

20	24
14	12

3 Range les nombres dans l'ordre décroissant.

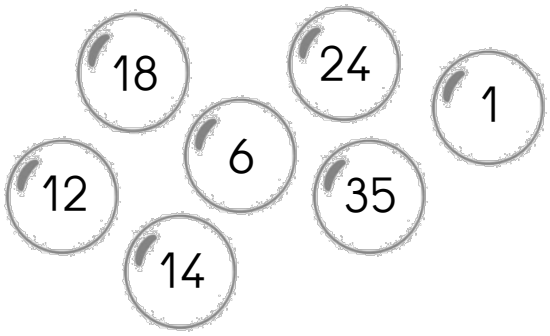

4 Construis des collections selon la consigne.



Il en faut 5 de moins.

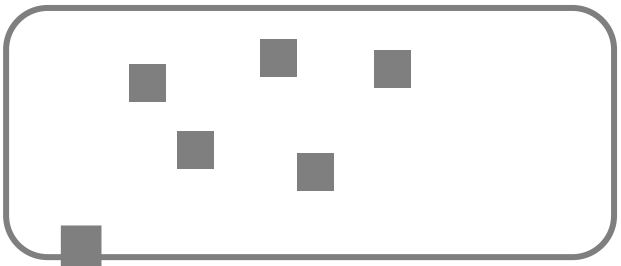

Il en faut 7 de plus.

MONSTRES en classe

MODULE 4
fiche 3 ★★★

1 Complète pour respecter la consigne.
Le plus petit nombre est souligné,
le plus grand nombre est entouré.

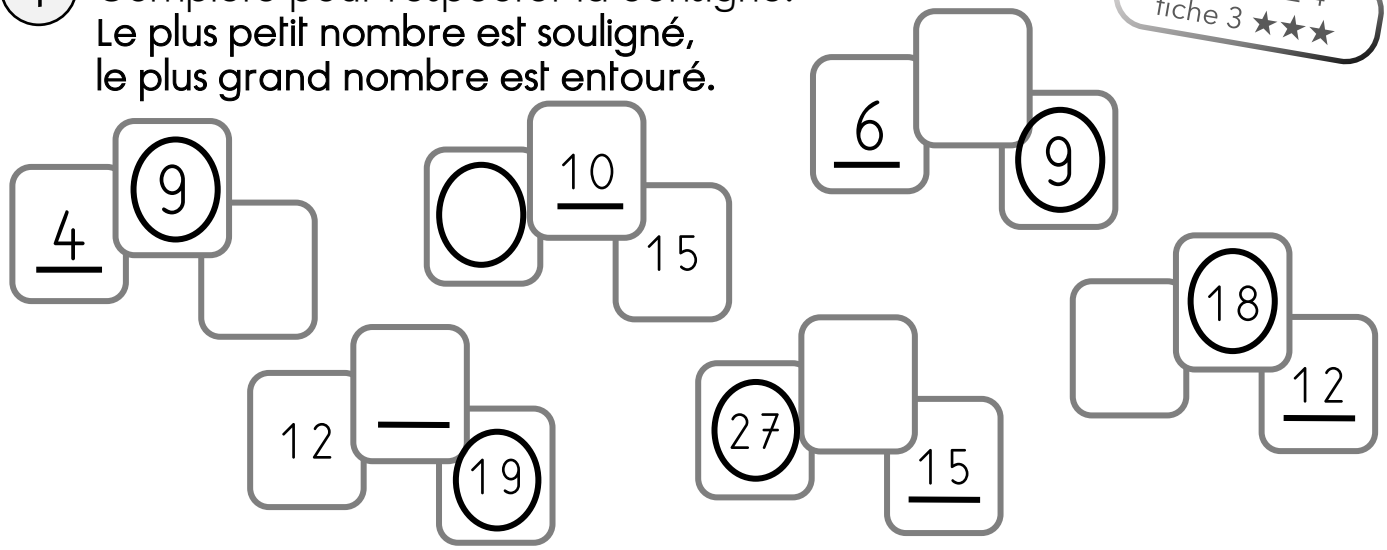

2 Choisis des nombres en respectant l'ordre croissant.

7	10		15	18		23	27	

3 Complète la phrase.

13	16	21	26	29

Ces nombres sont rangés dans l'ordre _____ .

4 Trouve la carte mal rangée et barre-la.

35	31	22	24	20	16	14	8	6

5 Colorie les nombres qui peuvent se placer sous la tache.

10	13	16	18	22		27	30	34



MONSTRES en classe

ibrandify
freepik
kiranshastry
smashicons
True3 Art